Ad Soyad: _____ Tarih: _____



Analog ve Dijital

3. Sınıf Matematik, Saatler

A Aynı saati gösteren dijital saati bulalım. Saatin numarasını kutuya yazalım.

1 

2 

3 

4 

5 

6 

06:35		07:20	1	10:05		09:45		11:10		08:55	

B Dijital saat gibi yazalım.

1 

0 9 : 1 2

2 

□□ : □□

3 

□□ : □□

4 

□□ : □□

5 

□□ : □□

6 

□□ : □□

Analog ve Dijital

3. Sınıf Matematik, Saatler



C Dijital saati okuyalım, satıra sözle yazalım. Sonra akrebi ve yelkovanı çizelim.

1 07:05 yediyi beş geçiyor



2 08:30 _____



3 09:15 _____



4 10:45 _____



5 06:20 _____



6 11:50 _____



7 07:25 _____



8 08:12 _____

