Ad Soyad: _____ Tarih: _____



Dakikaları Sayalım

3. Sınıf Matematik, Saatler

A Yelkovan bu sayının üstündeyse kaç dakika geçmiştir? Beşer sayalım, kutulara yazalım.

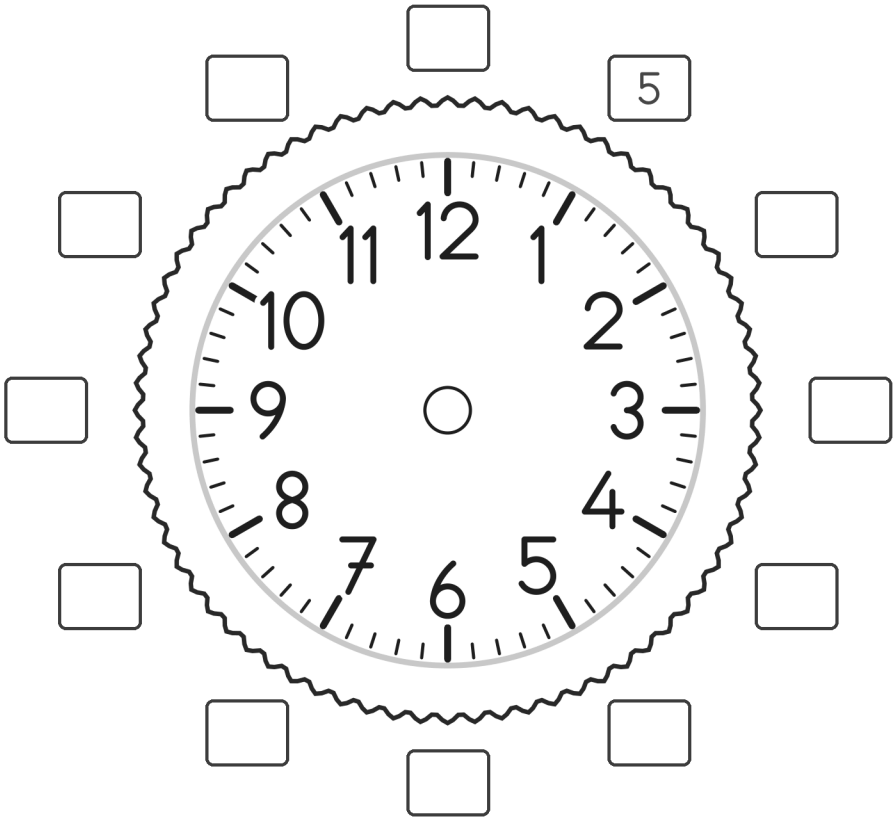

B Kaç dakika geçmiş? Kutuya yazalım.

1 

20 dakika

2 

_____ dakika

3 

_____ dakika

4 

_____ dakika

5 

_____ dakika

6 

_____ dakika

7 

_____ dakika

8 

_____ dakika